Great MathWorksheets

Grade 1 – Lesson 4

# Math Practice Sheets

## Addition Exploration Part II

**Examples**

**Practice Questions**

**Extra Challenge Unit**

Student Name

_____

Unit 4.1

# Addition Using a Number Line

**Example**

Write an addition sentence using a number line.

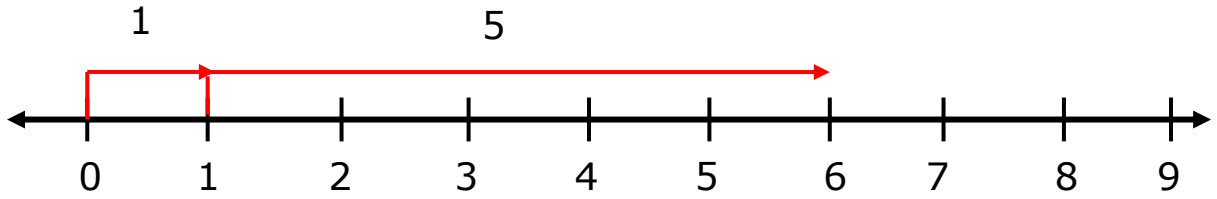


1 + 5 = 6

**Exercise**

1. Write an addition sentence and solve.

a)

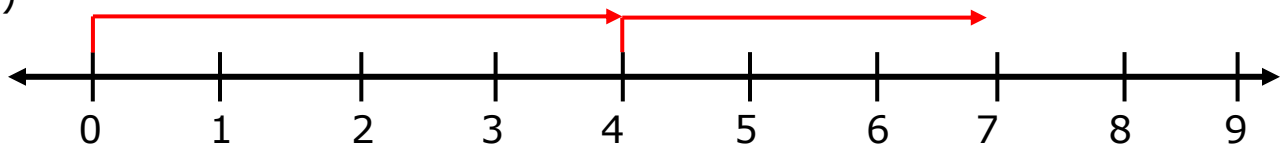


4 + ☐ = 7

b)

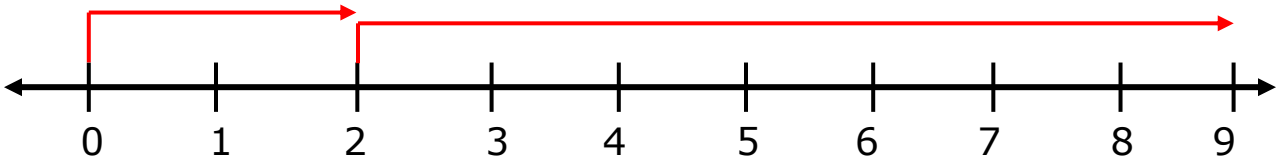


☐ + 7 = ☐

c)

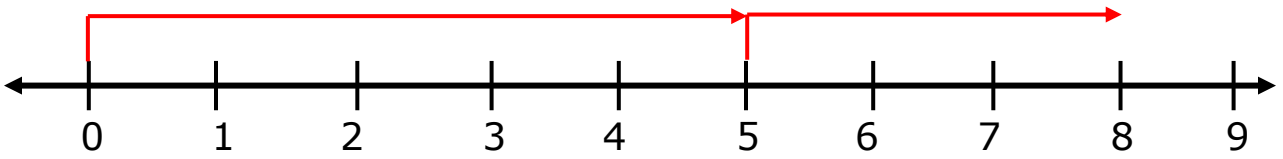


☐ + ☐ = ☐

© Great Math Worksheets. Unauthorized copying or reproduction of this worksheet is strictly prohibited.